Name _____ Date _____

Practice
Lesson 6

Patterns in Geometry

Find the pattern and draw the next figure.
Use the grid below.

1

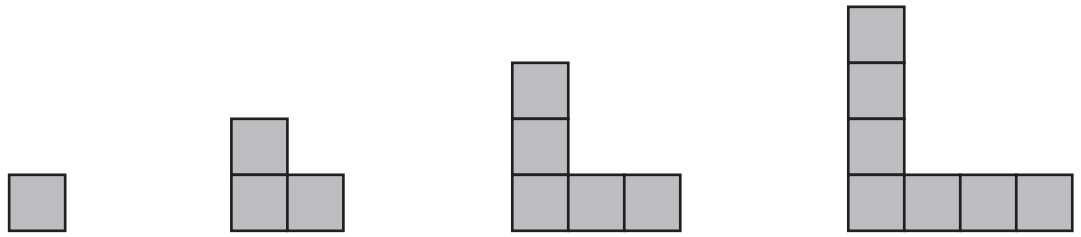

2

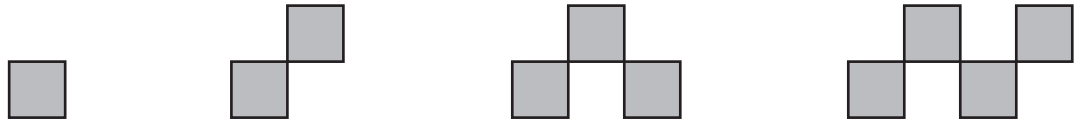



Test Prep

3 Darius puts 36¢ into two piles. One pile of coins is worth twice as much as the other. What is the smallest number of coins that could be in the more valuable pile?

A. 6 **C.** 8

B. 7 **D.** 9

© Education Development Center, Inc.