Name _____ Date _____

Practice
Lesson 4

Connecting Decimals to Fractions

Fill in the fraction notation (above the picture) and decimal notation (below the picture) to match the blocks.

Example

$2 + \frac{4}{10} + \frac{5}{100} = 2\frac{45}{100}$

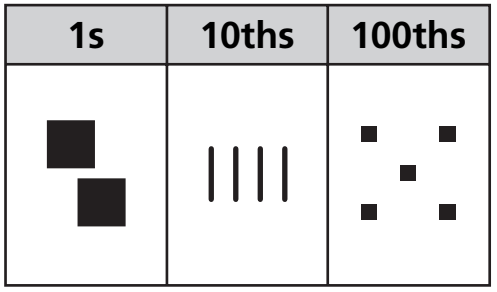

2 . 4 5

1 $\square + \frac{\square}{10} + \frac{3}{100} = \frac{\square}{100}$

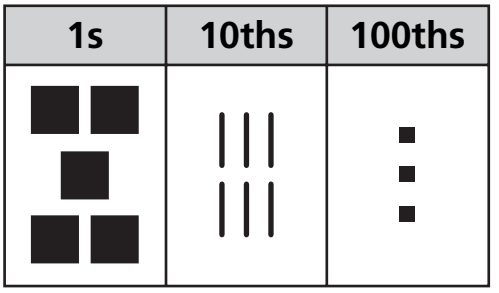

□ . □ □

2 □ + □ + □ = □

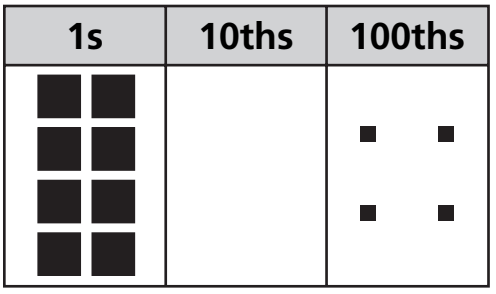

□ . □ □

3 □ + □ + □ = □

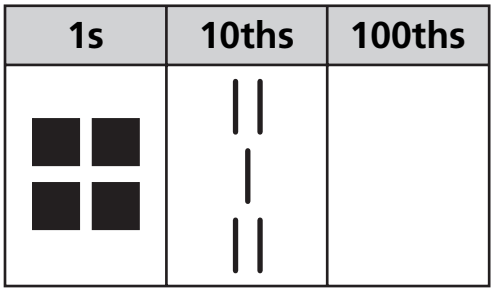

□ . □ □

Test Prep

4 Lucie swam 50 meters in more than 31.5 seconds, but less than 31.6 seconds. Name three different answers for how long she could have taken. Explain your answer.

_____

_____

© Education Development Center, Inc.